Stops Year 1, Fractions

Skill: To recognise, find and name a half as one of two equal parts of an object, shape or quantity.

Step 1

1. Halves must be 2 equal parts.

Which shapes show halves?

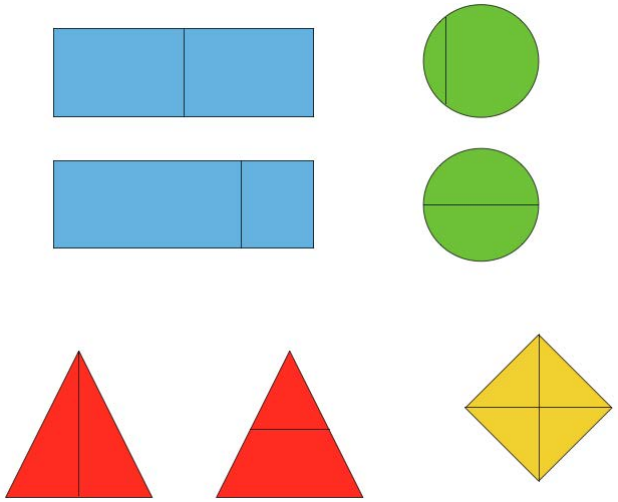

Step 2

1. Colour half of each shape:

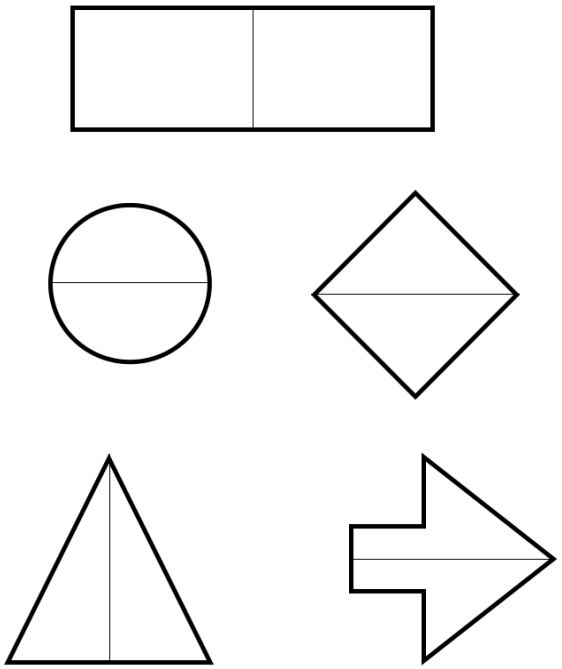

Step 3



What is half of 2?

What is half of 4?

What is half of 6?

What is half of 8?

© Stopsproblemsolving UK - 2018